Nombre: _____ Fecha: _____

Dibuja las agujas: "en punto" o "y media".

1 Dibuja la hora de antes o de después.

01:00
Media hora después ↓

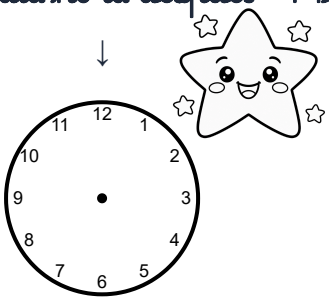

04:00
Media hora antes ↓

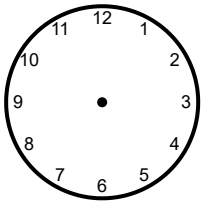

07:30
Media hora después ↓

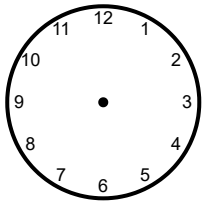

10:00
Media hora antes ↓

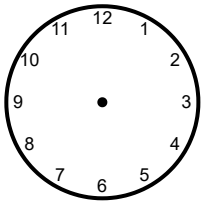

02:00
Media hora después ↓

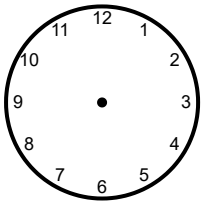

05:30
Media hora antes ↓



08:00
Media hora después ↓

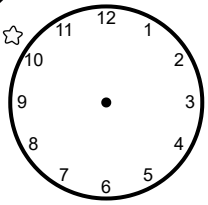

11:30
Media hora antes ↓

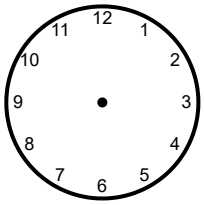

03:00
Media hora después ↓

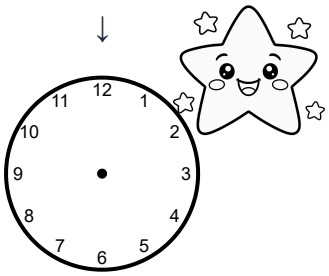

06:30
Media hora antes ↓

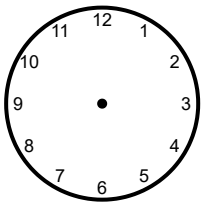

09:00
Media hora después ↓

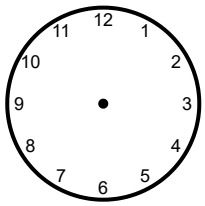

12:30
Media hora antes ↓

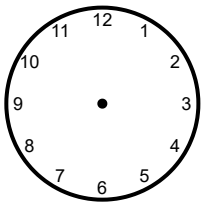

01:00
Media hora después ↓

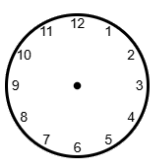

04:00
Media hora antes ↓

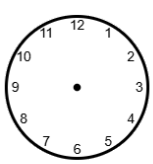

07:30
Media hora después ↓

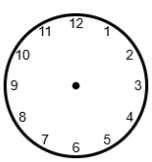

10:30
Media hora antes ↓

