Nombre: _____ Fecha: _____

Media hora antes o después

1 Escribe la hora en el reloj digital.



Media hora después: ☐:☐



Media hora después: ☐:☐



Media hora antes: ☐:☐



Media hora antes: ☐:☐



Media hora después: ☐:☐



Media hora después: ☐:☐



Media hora antes: ☐:☐



Media hora antes: ☐:☐



Media hora después: ☐:☐



Media hora después: ☐:☐



Media hora antes: ☐:☐



Media hora antes: ☐:☐



Media hora después: ☐:☐



Media hora después: ☐:☐



Media hora antes: ☐:☐



Media hora antes: ☐:☐

